METS L'I METS L'O

Voici dans le désordre, huit étapes de la construction de la Figure ci-contre.



Un petit malin s'est amusé à verser de l'encre sur les étapes I et O.

Quelles peuvent-être ces étapes cachées ?
Dessine-les et remets les étapes dans l'ordre.

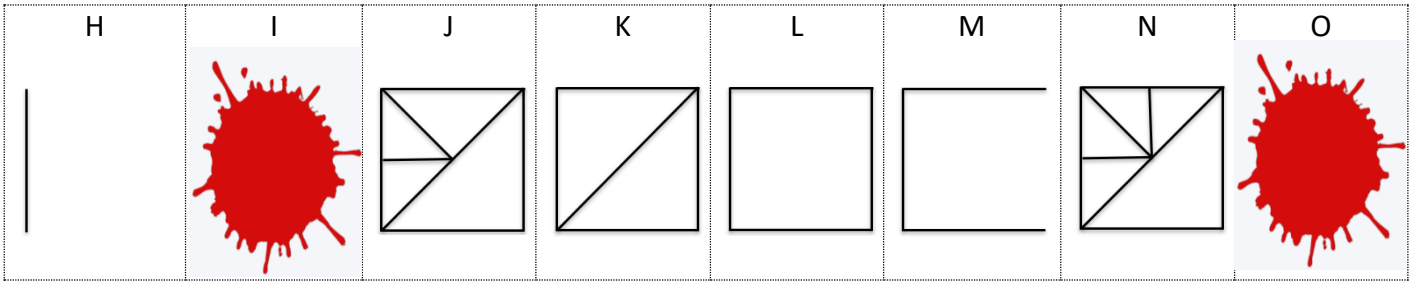

SOLUTION-Série ROUGE - GEOMETRIE

H	I ou O 	M 	L 
K 	I ou O 	J 	N